6 규칙 찾기

공부할 준비가 되어 있나요

1 덧셈표에서 규칙을 찾아 □ 안에 알맞은 수를 써넣으세요.

+	0	1	2	3	4	5	6	7	8	9
10	10	11	12	13	14	15	16	17	18	19
11	11	12	13		15	16	17	18	19	20
12	12	13	14	15	16		18	19	20	21
13	13	14		16	17	18	19	20	21	22
14	14	15	16	17	18		20	21	22	23
15	15		17	18	19	20	21	22	23	24
16	16	17	18	19	20	21	22	23	24	25
17	17	18	19	20	21	22	23	24	25	26
18	18	19	20	21	22	23	24	25	26	27
19	19	20	21	22	23	24	25	26	27	28

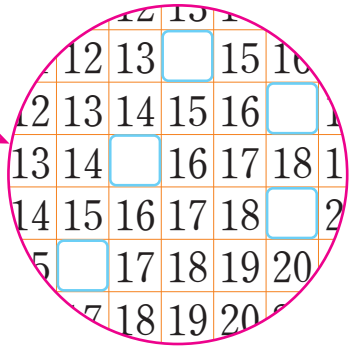

2 곱셈표에서 규칙을 찾아 □ 안에 알맞은 수를 써넣으세요.

×	0	1	2	3	4	5	6	7	8	9
0	0	0	0	0	0	0	0	0	0	0
1	0	1	2	3	4	5	6	7	8	9
2	0	2	4	6	8	10	12	14	16	18
3	0	3	6	9	12	15	18	21	24	27
4	0	4	8	12	16	20	24	28	32	36
5	0	5	10	15	20	25	30		40	45
6	0	6	12	18	24	30	36	42	48	54
7	0	7	14	21	28	35	42	49	56	63
8	0	8	16	24	32	40		56		
9	0	9	18	27	36	45	54		72	81

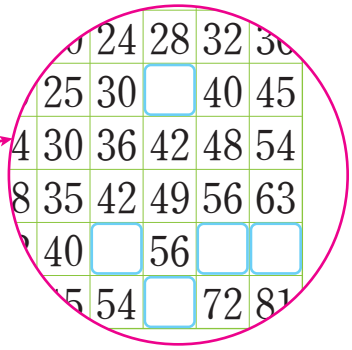

3 규칙에 따라 □ 안에 알맞은 모양을 그리고 색칠해 보세요.



4 규칙에 따라 쌓기나무를 쌓을 때 빈칸에 쌓을 쌓기나무는 몇 개일까요?

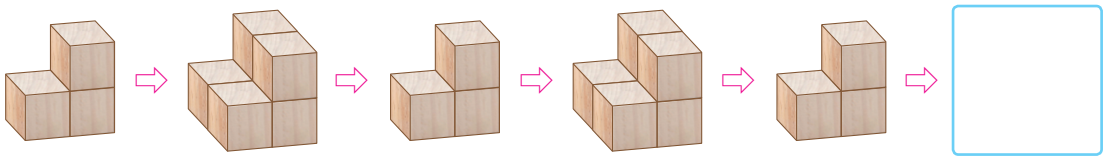

(　　)개